Division am Zahlenstrahl darstellen

Dividiere $\frac{2}{3}$ durch 2; 3; 4; 5; 6 und 8.

Zeichne die Lösung in den Zahlenstrahl ein.

Beispiel:

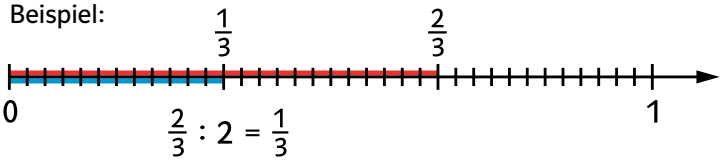

$\frac{2}{3} : 3 =$ _____

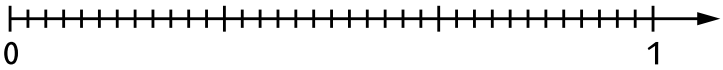

$\frac{2}{3} : 4 =$ _____

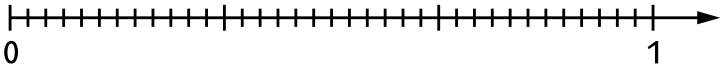

$\frac{2}{3} : 5 =$ _____

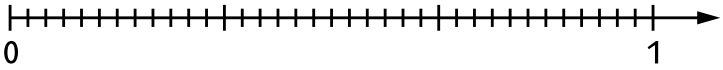

$\frac{2}{3} : 6 =$ _____

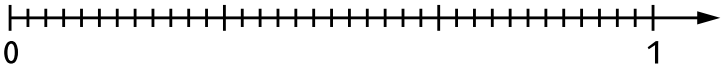

$\frac{2}{3} : 8 =$ _____

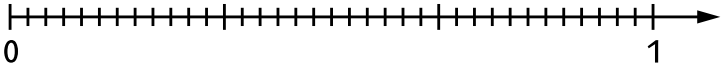

Dividiere $\frac{3}{4}$ durch 2; 3; 6 und 9.

Zeichne die Lösung in den Zahlenstrahl ein.

$\frac{3}{4} : 2 =$ _____

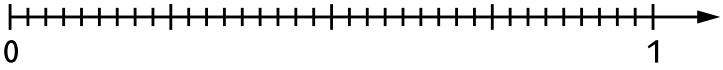

$\frac{3}{4} : 3 =$ _____

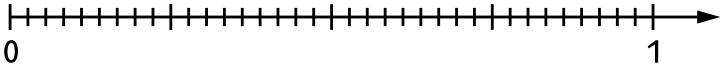

$\frac{3}{4} : 6 =$ _____

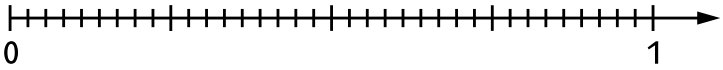

$\frac{3}{4} : 9 =$ _____

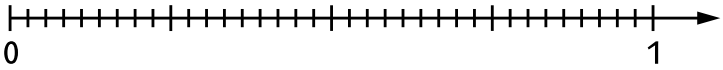

© Ernst Klett Verlag GmbH, Stuttgart 2012 | www.klett.de | Alle Rechte vorbehalten
Von dieser Druckvorlage ist die Vervielfältigung für den eigenen Unterrichtsgebrauch gestattet. Die Kopiergebühren sind abgegolten.

Schnittpunkt 6,
Niedersachsen
ISBN 978-3-12-742151-4